NAME _____ DATE _____

Problems for *Close to 100*

Suppose that you are dealt these hands in the game *Close to 100.* Which numbers would you make to get sums as close to100 as possible?

1

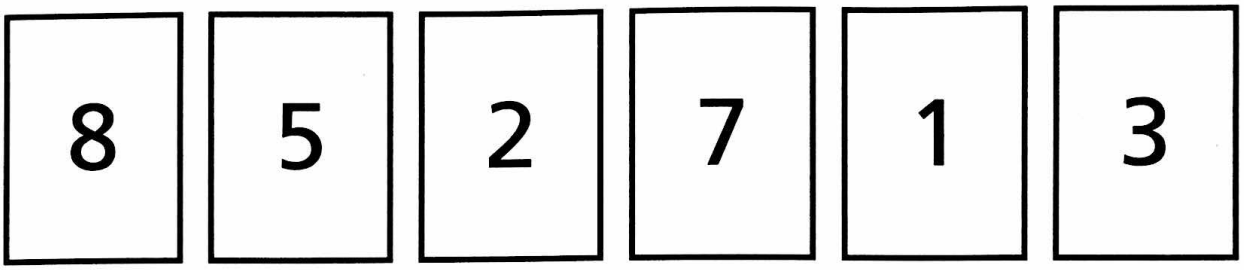

_____ _____ + _____ _____ = _____ **Score**

2

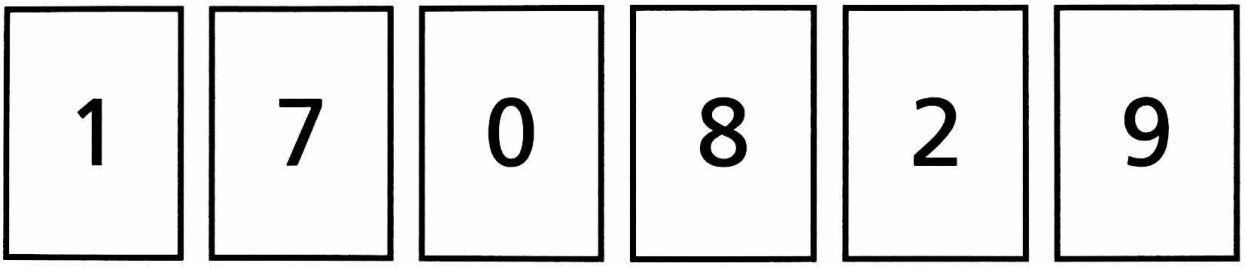

_____ _____ + _____ _____ = _____ **Score**

3

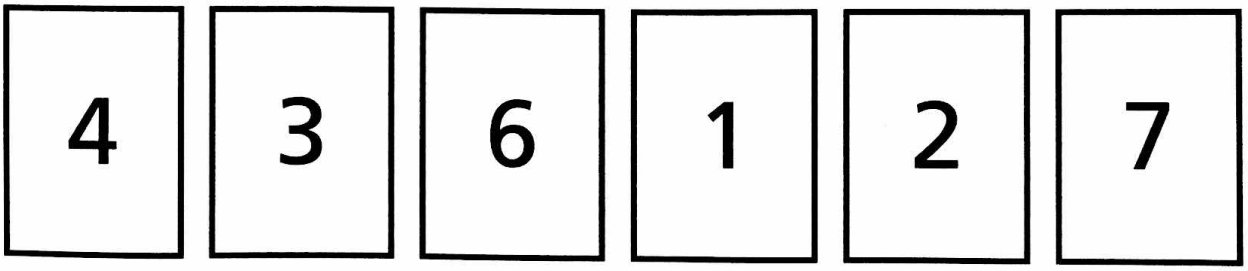

_____ _____ + _____ _____ = _____ **Score**

NOTE

Students practice finding pairs of 2-digit numbers that add to 100. Ask your child to explain how he or she chose which cards to use.

MWI **Addition Strategies: Changing the Numbers**

© Pearson Education 3